

81 Degrees West
Exhibition Worksheet

Name: _____

Look at the map of Grand Cayman. Write the location for each item using the grid points.

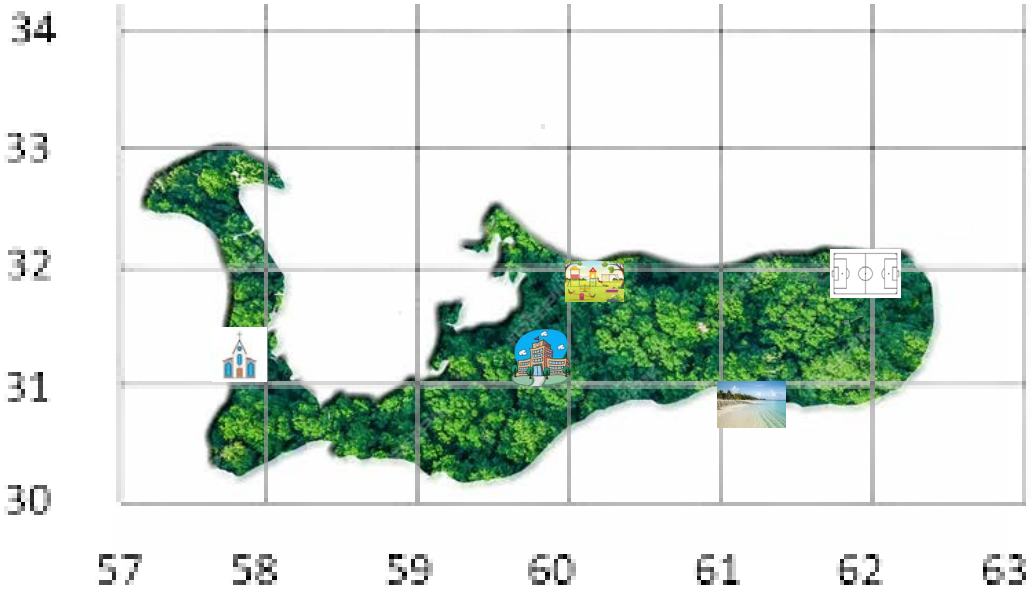

Key

Church 

Park 

Beach 

Football Field 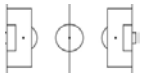

School 

1) Where is the church? _____

2) Where is the park? _____

3) Where is the beach? _____

4) Where is the football field? _____

5) Where is the school? _____

COMPASS DIRECTIONS

Use the compass to give you the directions for the different districts.

West Bay 		North Side 		
		START		East End 
		Bodden Town 		
George Town 				

1) What is the direction for West Bay? _____

2) What is the direction for North Side? _____

3) What is the direction for George Town? _____

4) What is the direction for North Side? _____

5) What is the direction for East End? _____

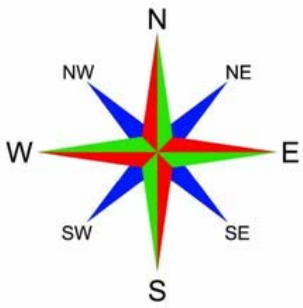



TOOLS OF THE TRADE



Use a drawing compass and ruler to replicate the design in the box below.

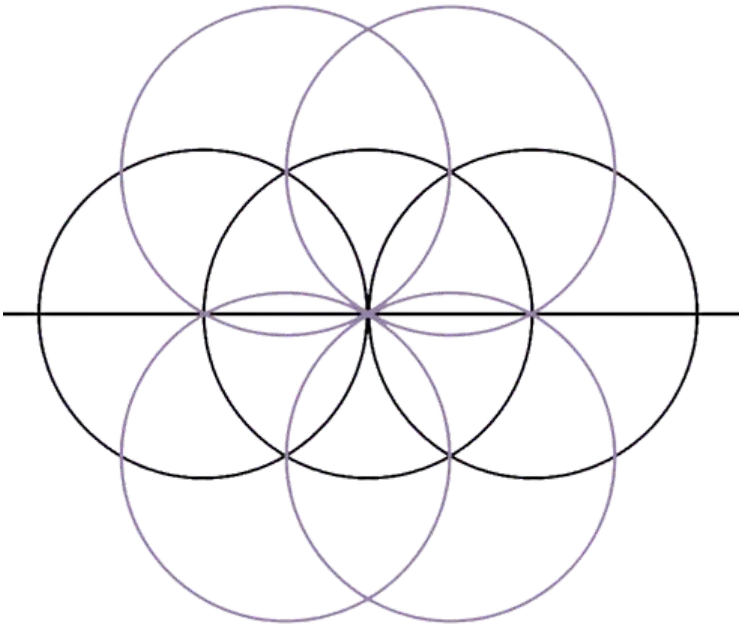

MAKING AN EXHIBITION MAP

Here is a map of the National Gallery's exhibition hall. Using their assigned numbers, place each artwork in the correct location on the map.

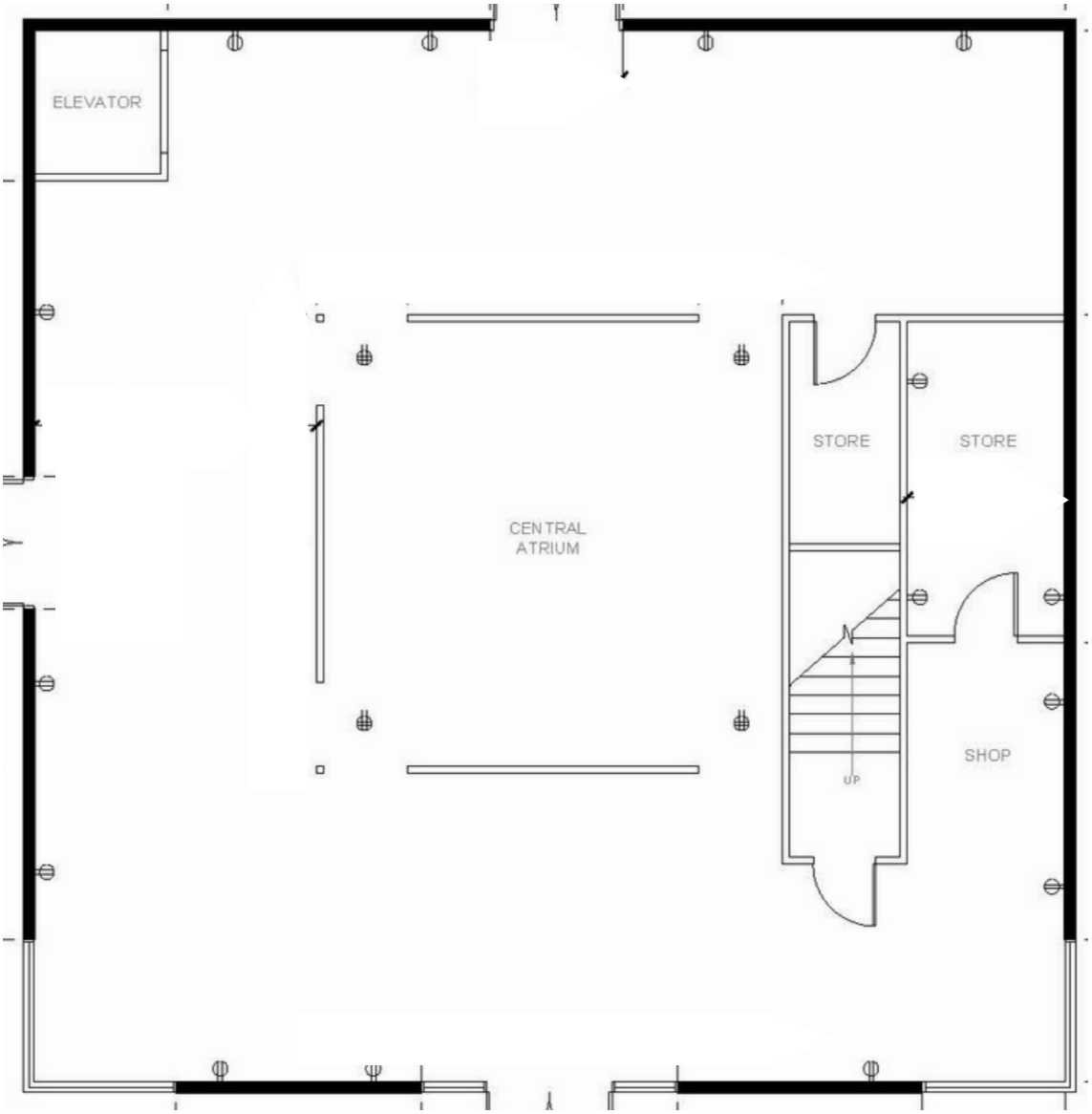

1 

2 

3 

4 

5 

6 

7 

8 

Pick two countries you would like to visit from the Caribbean map that is given. Then draw each of them in the boxes below.



Country One

Country Two